① Colora di rosso i rettangoli, di azzurro i triangoli, di rosa i trapezi e di giallo gli altri poligoni.



② Misura con il righello e calcola il perimetro di queste figure (scrivi le misure dei lati sulla figura).

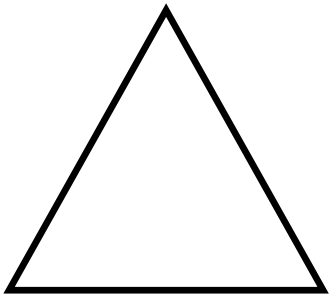

P =_____

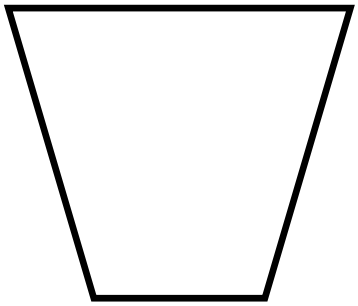

P =_____

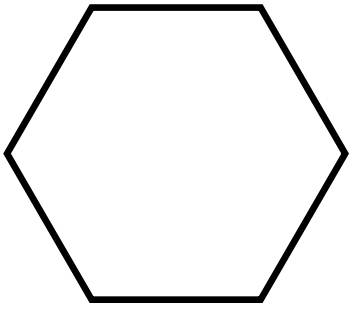

P =_____



P =_____